Diviser avec une Droite Numérique

Nom:

Utilisez la droite numérique pour résoudre chaque problème.

1) 24÷6=

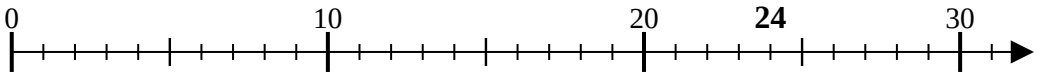

2) 21÷7=

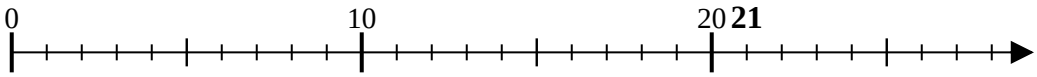

3) 4÷2=

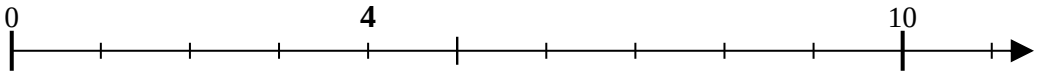

4) 16÷4=

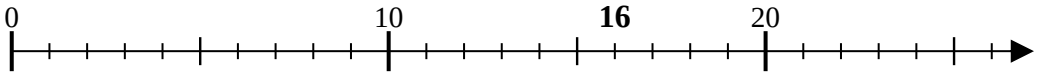

5) 12÷4=

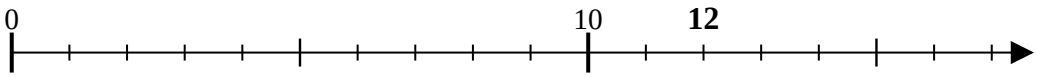

6) 12÷3=

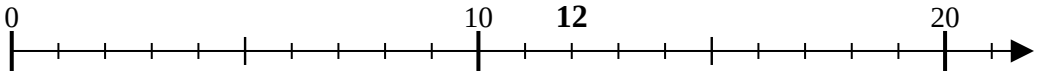

7) 6÷2=

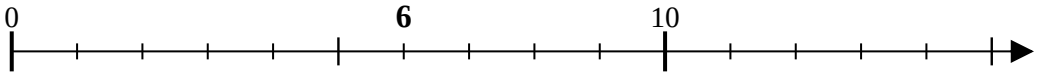

8) 20÷5=

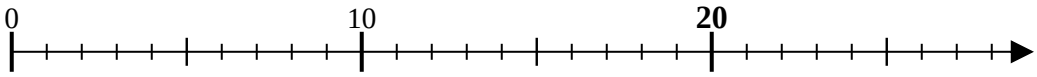

9) 18÷6=

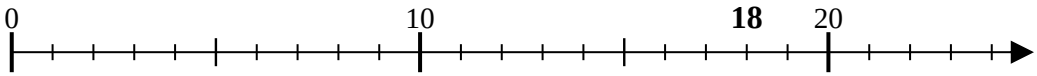

10) 30÷10=

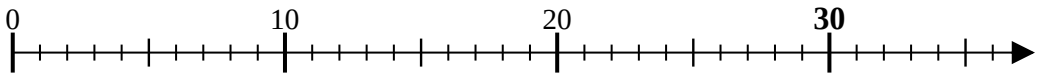

11) 32÷8=

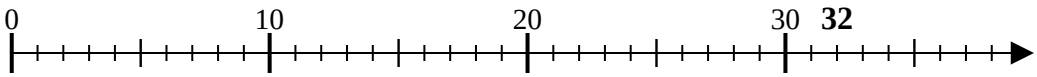

Réponses

1. _____
2. _____
3. _____
4. _____
5. _____
6. _____
7. _____
8. _____
9. _____
10. _____
11. _____

1-10	91	82	73	64	55	45	36	27	18	9
11	0									

Diviser avec une Droite Numérique Nom: **Clé**

Utilisez la droite numérique pour résoudre chaque problème.

1) 24÷6=

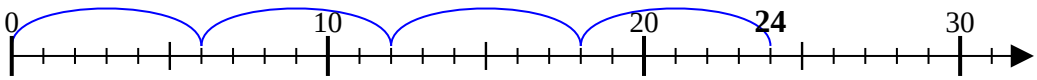

2) 21÷7=

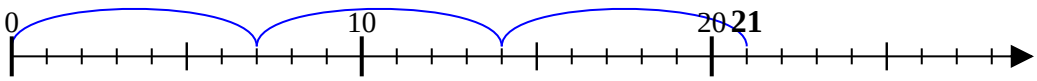

3) 4÷2=

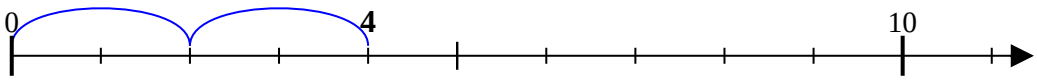

4) 16÷4=

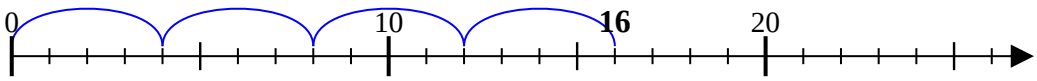

5) 12÷4=

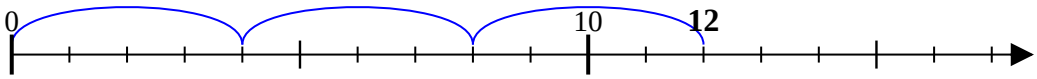

6) 12÷3=

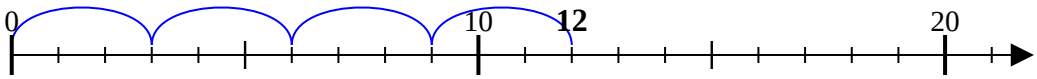

7) 6÷2=

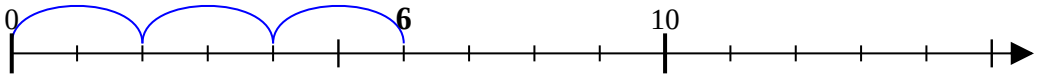

8) 20÷5=

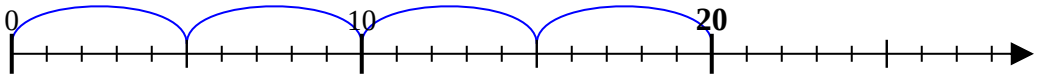

9) 18÷6=

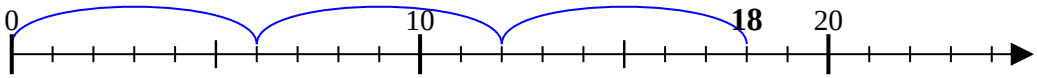

10) 30÷10=

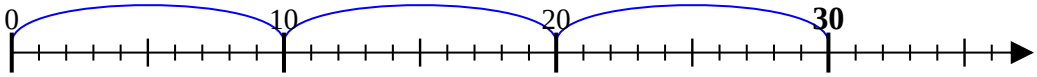

11) 32÷8=

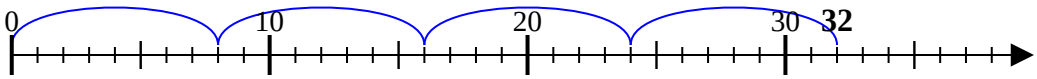

Réponses

1. **4**
2. **3**
3. **2**
4. **4**
5. **3**
6. **4**
7. **3**
8. **4**
9. **3**
10. **3**
11. **4**