Multiplication de Fractions (visuelle)

Nom:

Utilisez la grille comme exemple afin de multiplier les deux fractions.

Ex) $\frac{2}{4} \times \frac{1}{3} =$

1) $\frac{1}{2} \times \frac{3}{7} =$

2) $\frac{5}{9} \times \frac{3}{6} =$

3) $\frac{1}{3} \times \frac{1}{4} =$

4) $\frac{4}{7} \times \frac{2}{8} =$

5) $\frac{1}{2} \times \frac{2}{4} =$

6) $\frac{7}{8} \times \frac{4}{7} =$

7) $\frac{2}{9} \times \frac{1}{4} =$

8) $\frac{3}{4} \times \frac{5}{8} =$

9) $\frac{2}{7} \times \frac{1}{2} =$

10) $\frac{1}{5} \times \frac{2}{5} =$

11) $\frac{2}{9} \times \frac{2}{5} =$

Réponses

Ex. $^{2}/_{12}$

1. _____
2. _____
3. _____
4. _____
5. _____
6. _____
7. _____
8. _____
9. _____
10. _____
11. _____

1-10	91	82	73	64	55	45	36	27	18	9
11	0									

Multiplication de Fractions (visuelle) Nom: **Clé**

Utilisez la grille comme exemple afin de multiplier les deux fractions.

Ex) $\frac{2}{4} \times \frac{1}{3} =$



1) $\frac{1}{2} \times \frac{3}{7} =$

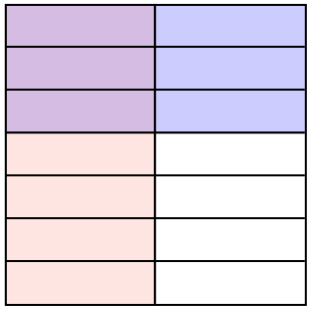

2) $\frac{5}{9} \times \frac{3}{6} =$

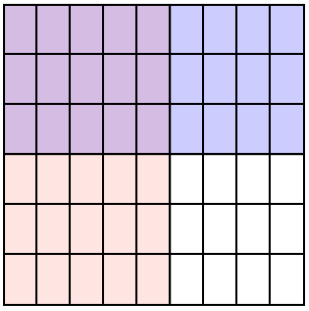

3) $\frac{1}{3} \times \frac{1}{4} =$



4) $\frac{4}{7} \times \frac{2}{8} =$

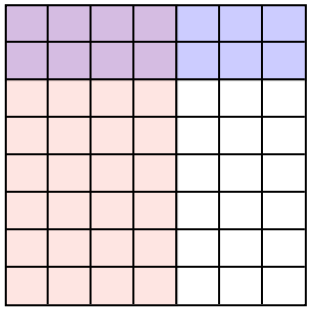

5) $\frac{1}{2} \times \frac{2}{4} =$



6) $\frac{7}{8} \times \frac{4}{7} =$

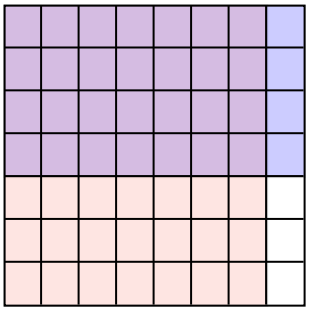

7) $\frac{2}{9} \times \frac{1}{4} =$

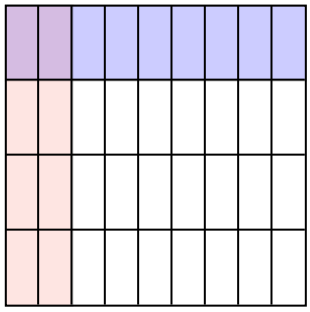

8) $\frac{3}{4} \times \frac{5}{8} =$

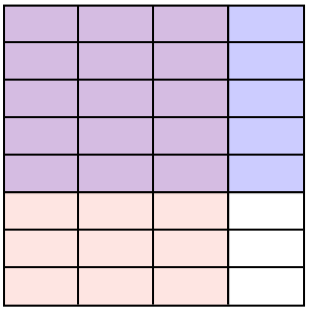

9) $\frac{2}{7} \times \frac{1}{2} =$

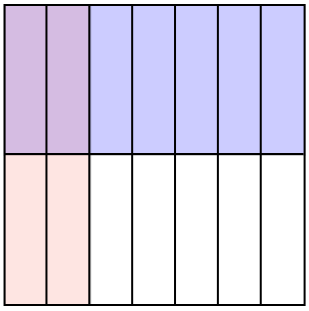

10) $\frac{1}{5} \times \frac{2}{5} =$

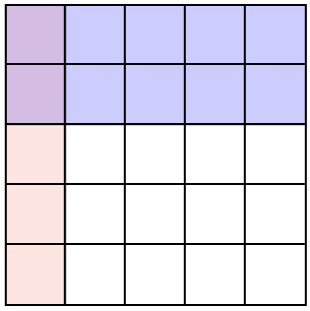

11) $\frac{2}{9} \times \frac{2}{5} =$

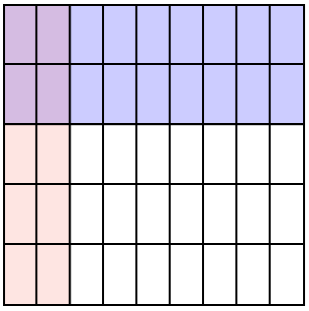

Réponses

Ex.	$\frac{2}{12}$
1.	$\frac{3}{14}$
2.	$\frac{15}{54}$
3.	$\frac{1}{12}$
4.	$\frac{8}{56}$
5.	$\frac{2}{8}$
6.	$\frac{28}{56}$
7.	$\frac{2}{36}$
8.	$\frac{15}{32}$
9.	$\frac{2}{14}$
10.	$\frac{2}{25}$
11.	$\frac{4}{45}$

1-10	91	82	73	64	55	45	36	27	18	9
11	0									