Compter des Figures Nom:

Comptez le nombre de figure de chaque boîte.



Ex) = 4

1) = _____

2) = _____

3) = _____



4) = _____

5) = _____

6) = _____

7) = _____

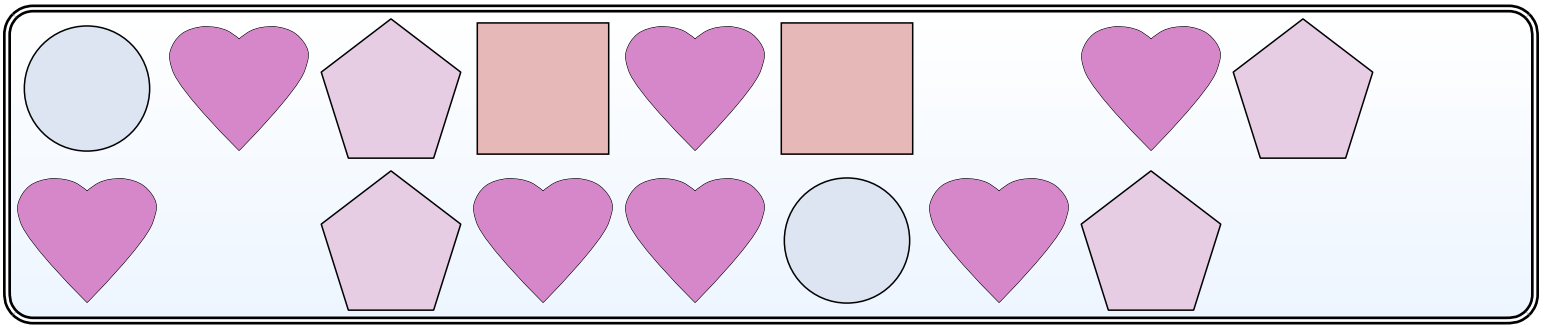

8) = _____

9) = _____

10) 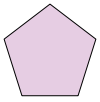 = _____

11) = _____

1-10	91	82	73	64	55	45	36	27	18	9
11	0									

Compter des Figures Nom: **Clé**

Comptez le nombre de figure de chaque boîte.



Ex) = 4

1) = 6

2) = 3

3) = 4



4) = 5

5) = 3

6) = 4

7) = 2

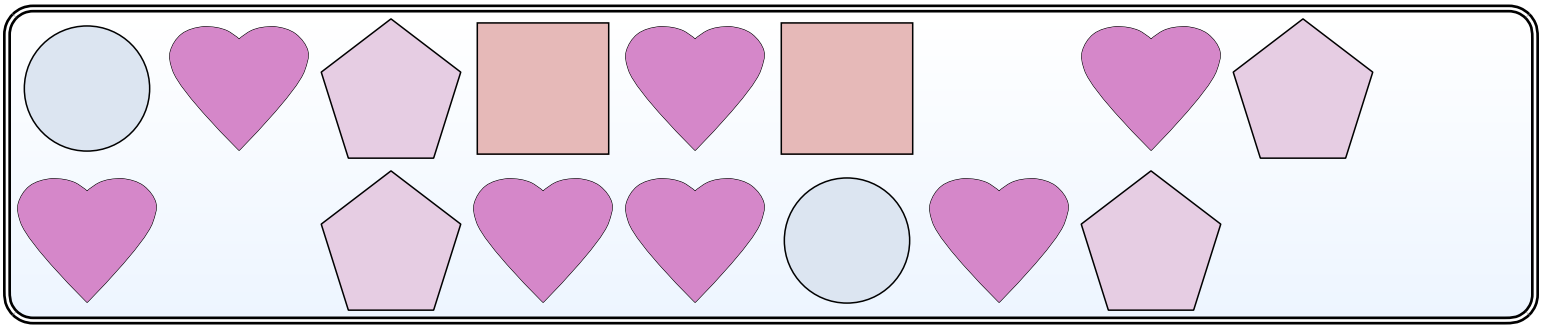

8) = 2

9) = 7

10) 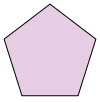 = 4

11) = 2

1-10	91	82	73	64	55	45	36	27	18	9
11	0									