Compter des Figures Nom:

**Comptez le nombre de figure de chaque boîte.**

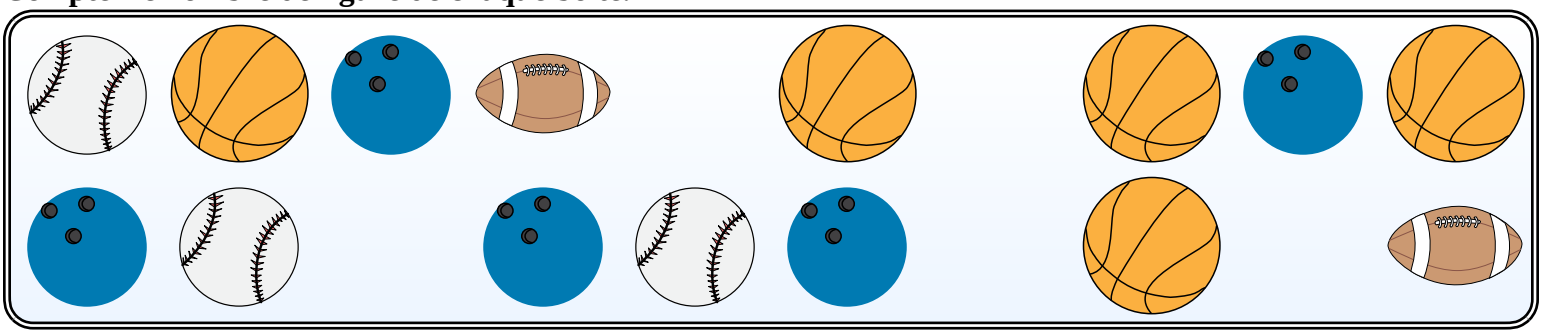

**Ex)** = 3

**1)** = _____

**2)** = _____

**3)** = _____



**4)** = _____

**5)** = _____

**6)** = _____

**7)** = _____



**8)** = _____

**9)** = _____

**10)** = _____

**11)** = _____



| | | | | | | | | | | |
|---|---|---|---|---|---|---|---|---|---|---|
| 1-10 | 91 | 82 | 73 | 64 | 55 | 45 | 36 | 27 | 18 | 9 |
| 11 | 0 | | | | | | | | | |

Compter des Figures Nom: **Clé**

**Comptez le nombre de figure de chaque boîte.**

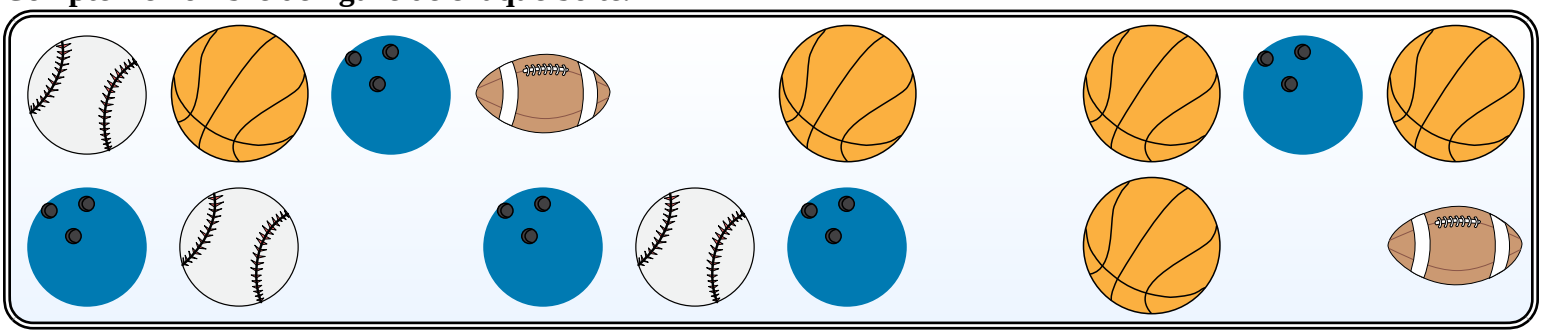

**Ex)** = 3

**1)** = 5

**2)** = 5

**3)** = 2



**4)** = 4

**5)** = 2

**6)** = 6

**7)** = 2



**8)** = 3

**9)** = 4

**10)** = 4

**11)** = 3



| | | | | | | | | | | |
|---|---|---|---|---|---|---|---|---|---|---|
| 1-10 | 91 | 82 | 73 | 64 | 55 | 45 | 36 | 27 | 18 | 9 |
| 11 | 0 | | | | | | | | | |

Compter des Figures Nom:

**Comptez le nombre de figure de chaque boîte.**

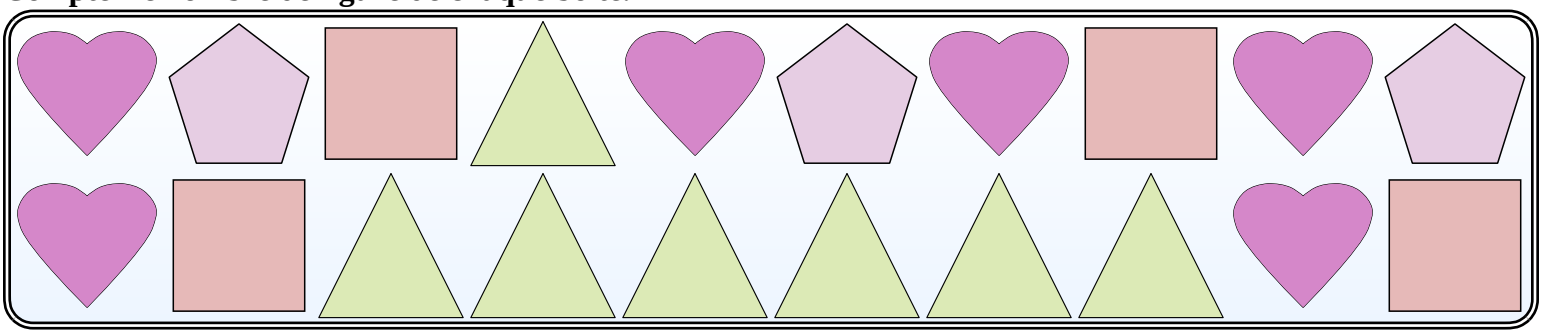

**Ex)** = 6

**1)** 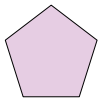 = _____

**2)** = _____

**3)** 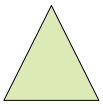 = _____

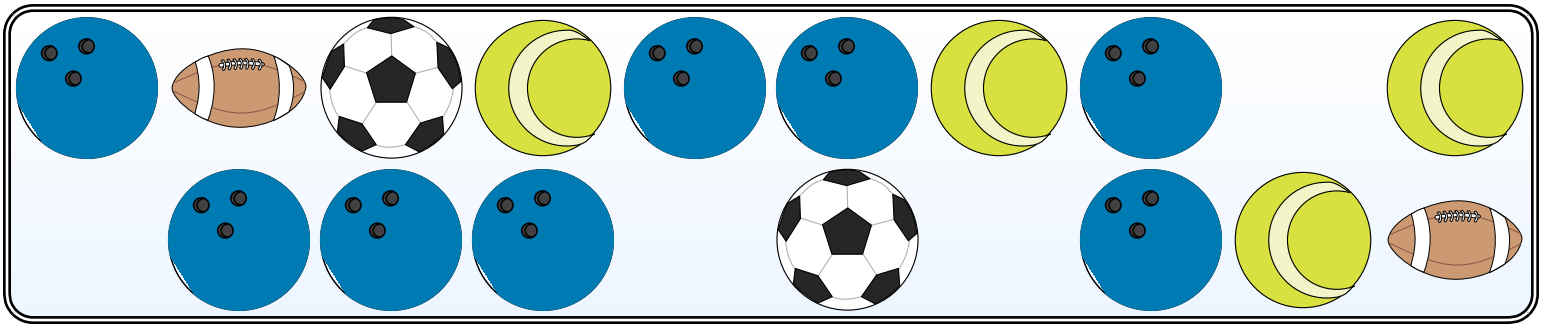

**4)** = _____

**5)** = _____

**6)** = _____

**7)** = _____



**8)** = _____

**9)** = _____

**10)** = _____

**11)** = _____



| | | | | | | | | | | |
|---|---|---|---|---|---|---|---|---|---|---|
| 1-10 | 91 | 82 | 73 | 64 | 55 | 45 | 36 | 27 | 18 | 9 |
| 11 | 0 | | | | | | | | | |

Compter des Figures Nom: **Clé**

**Comptez le nombre de figure de chaque boîte.**

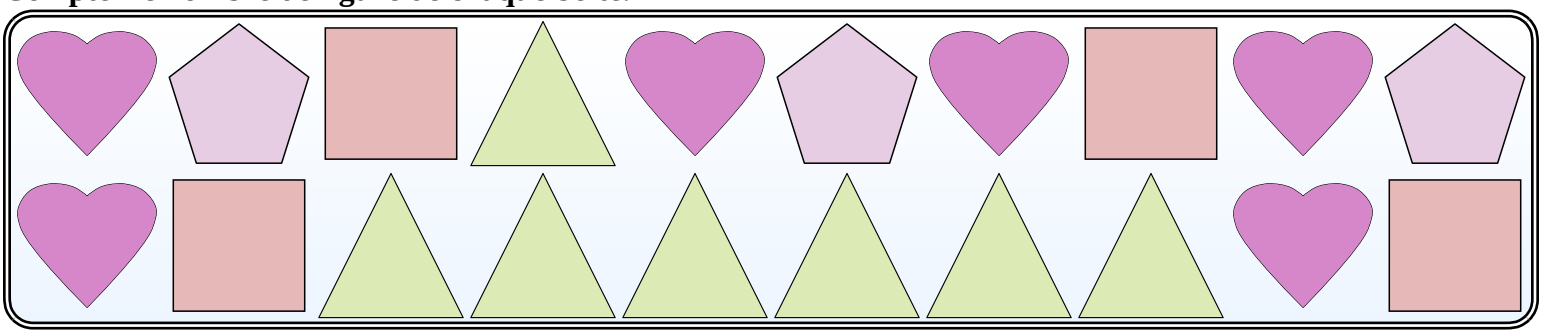

**Ex)** = 6

**1)** 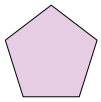 = 3

**2)** = 4

**3)** 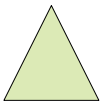 = 7

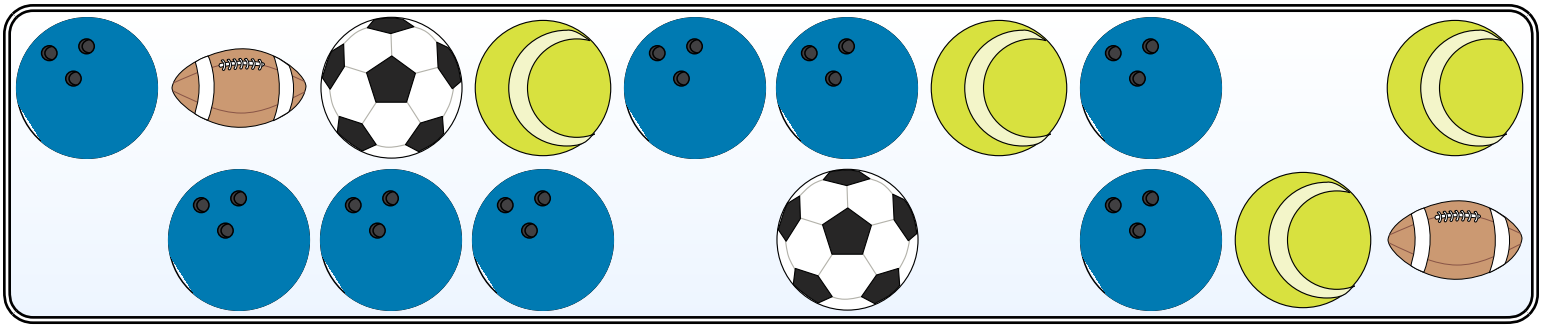

**4)** = 8

**5)** = 2

**6)** = 2

**7)** = 4



**8)** = 5

**9)** = 4

**10)** = 8

**11)** = 1



| | | | | | | | | | | |
|---|---|---|---|---|---|---|---|---|---|---|
| 1-10 | 91 | 82 | 73 | 64 | 55 | 45 | 36 | 27 | 18 | 9 |
| 11 | 0 | | | | | | | | | |

Compter des Figures Nom:

**Comptez le nombre de figure de chaque boîte.**

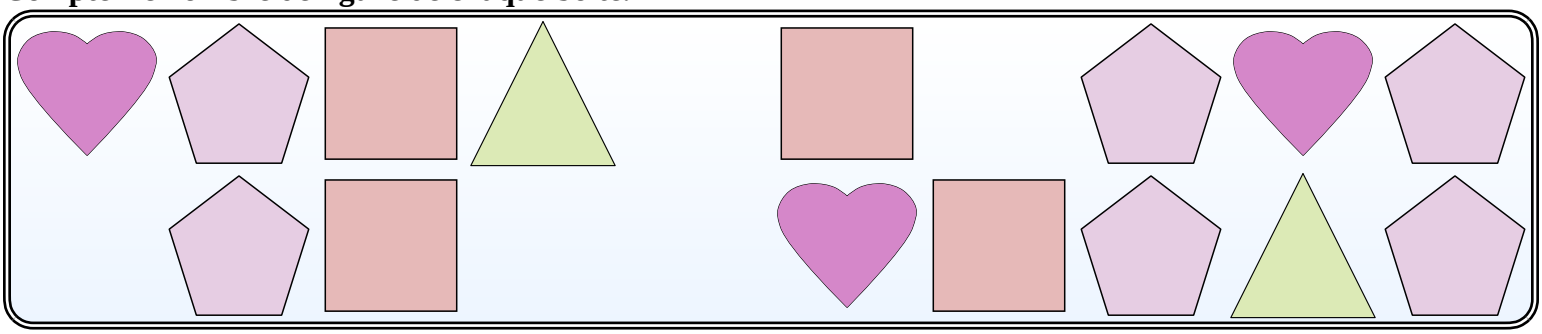

**Ex)** = 3

**1)** 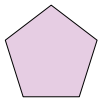 = _____

**2)** = _____

**3)** 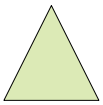 = _____

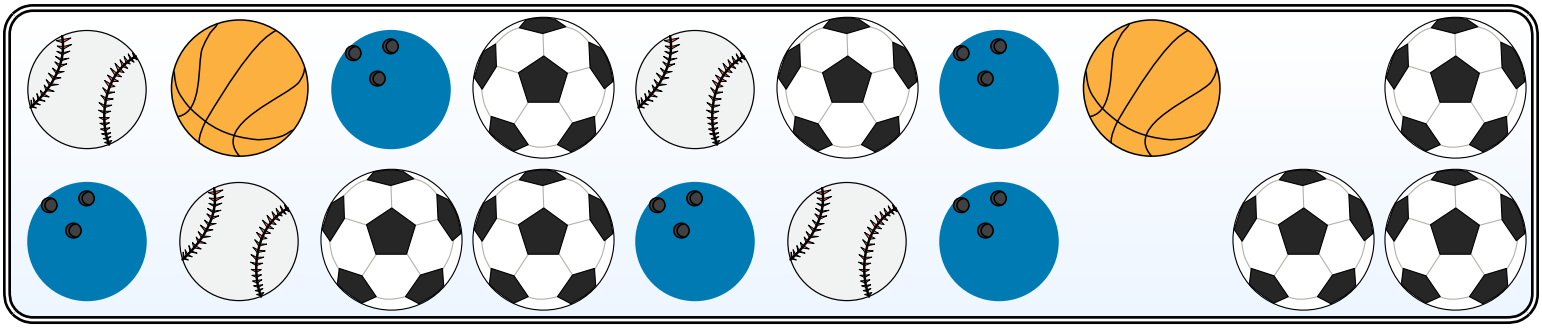

**4)** = _____

**5)** = _____

**6)** = _____

**7)** = _____



**8)** = _____

**9)** = _____

**10)** = _____

**11)** = _____



| | | | | | | | | | | |
|---|---|---|---|---|---|---|---|---|---|---|
| 1-10 | 91 | 82 | 73 | 64 | 55 | 45 | 36 | 27 | 18 | 9 |
| 11 | 0 | | | | | | | | | |

Compter des Figures Nom: **Clé**

**Comptez le nombre de figure de chaque boîte.**

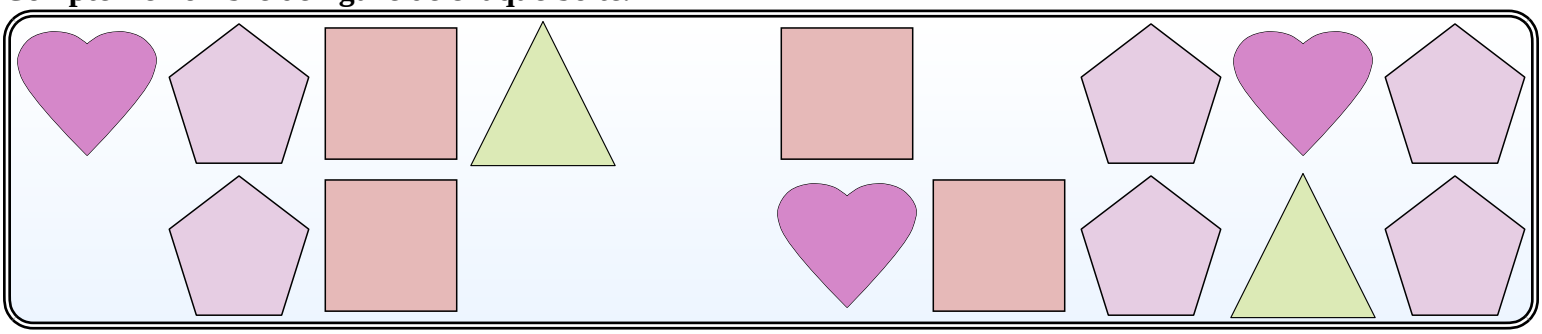

**Ex)** = 3

**1)** 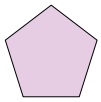 = 6

**2)** = 4

**3)** 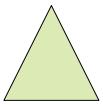 = 2

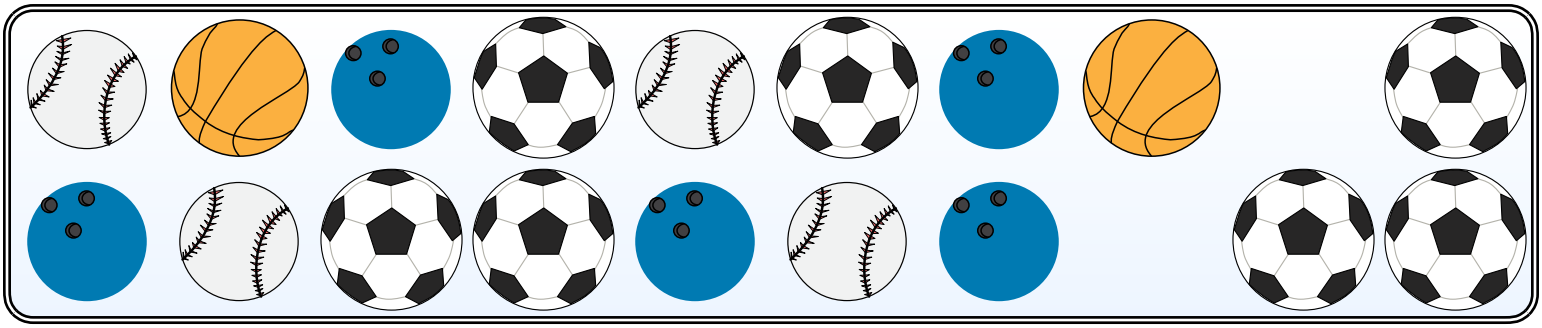

**4)** = 4

**5)** = 2

**6)** = 5

**7)** = 7



**8)** = 6

**9)** = 4

**10)** = 3

**11)** = 6



| | | | | | | | | | | |
|---|---|---|---|---|---|---|---|---|---|---|
| 1-10 | 91 | 82 | 73 | 64 | 55 | 45 | 36 | 27 | 18 | 9 |
| 11 | 0 | | | | | | | | | |

Compter des Figures Nom:

**Comptez le nombre de figure de chaque boîte.**

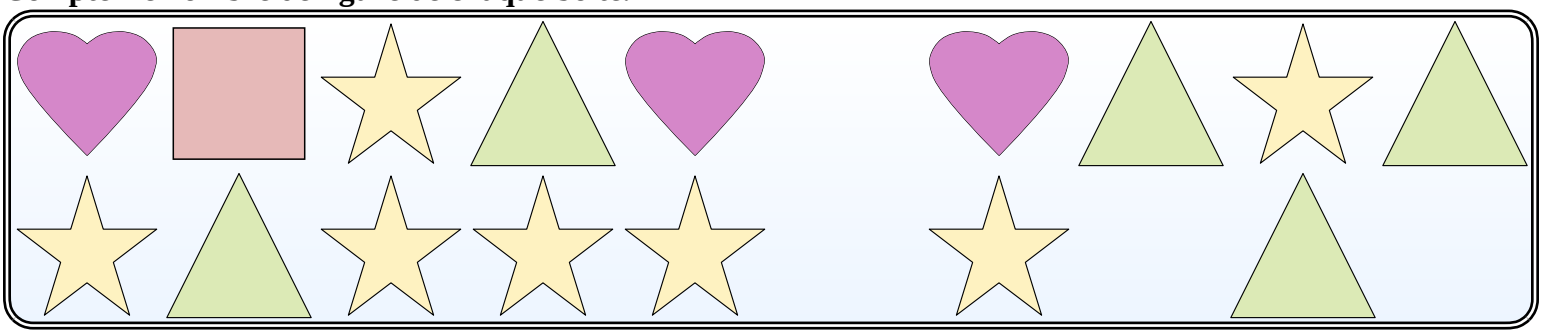

**Ex)** = 3

**1)** = _____

**2)** = _____

**3)** 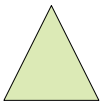 = _____

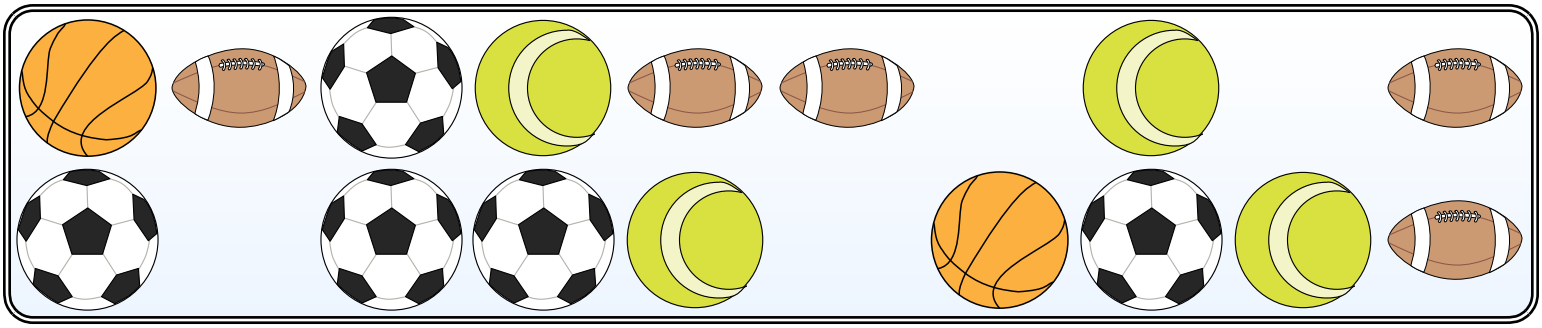

**4)** = _____

**5)** = _____

**6)** = _____

**7)** = _____



**8)** = _____

**9)** = _____

**10)** = _____

**11)** = _____



| | | | | | | | | | | |
|---|---|---|---|---|---|---|---|---|---|---|
| 1-10 | 91 | 82 | 73 | 64 | 55 | 45 | 36 | 27 | 18 | 9 |
| 11 | 0 | | | | | | | | | |

Compter des Figures Nom: **Clé**

**Comptez le nombre de figure de chaque boîte.**

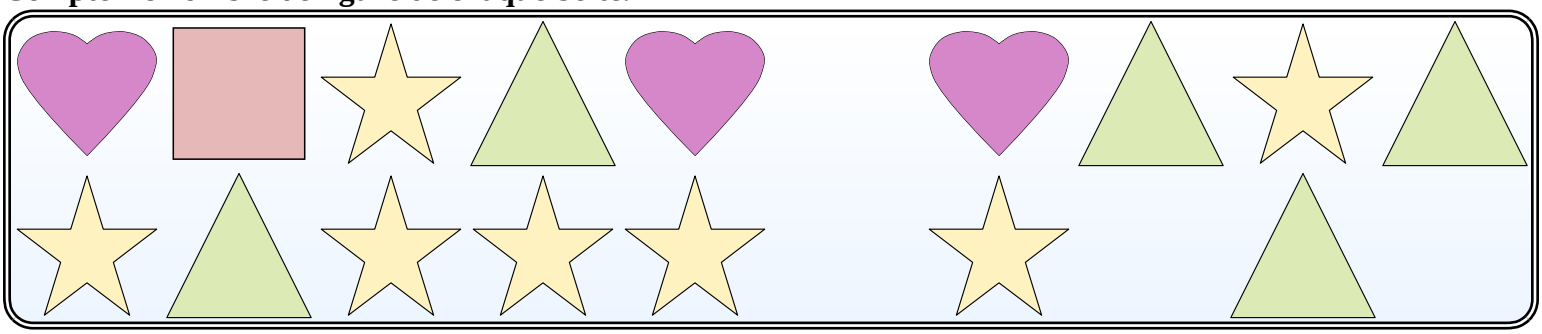

**Ex)** = 3

**1)** = 1

**2)** = 7

**3)** 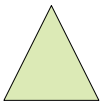 = 5

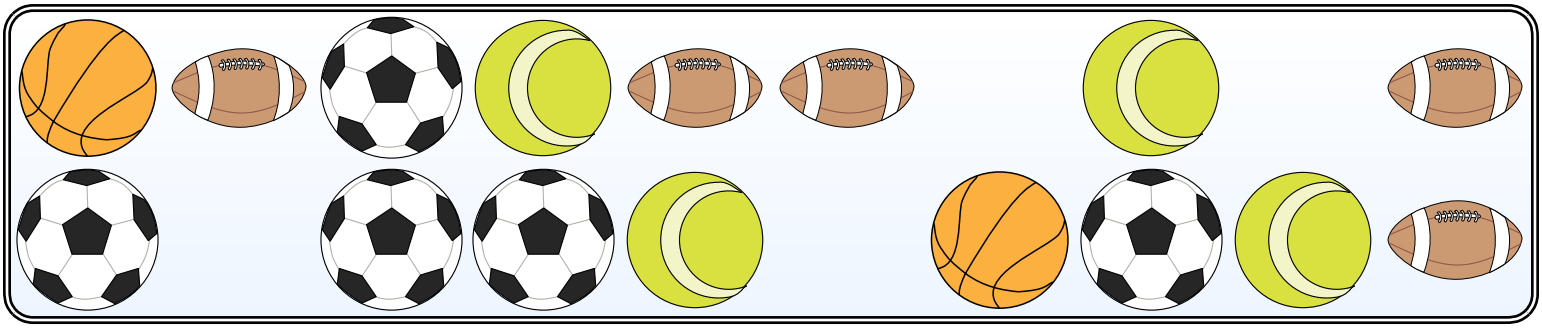

**4)** = 2

**5)** = 5

**6)** = 5

**7)** = 4



**8)** = 4

**9)** = 6

**10)** = 5

**11)** = 4



| | | | | | | | | | | |
|---|---|---|---|---|---|---|---|---|---|---|
| 1-10 | 91 | 82 | 73 | 64 | 55 | 45 | 36 | 27 | 18 | 9 |
| 11 | 0 | | | | | | | | | |

Compter des Figures Nom:

**Comptez le nombre de figure de chaque boîte.**

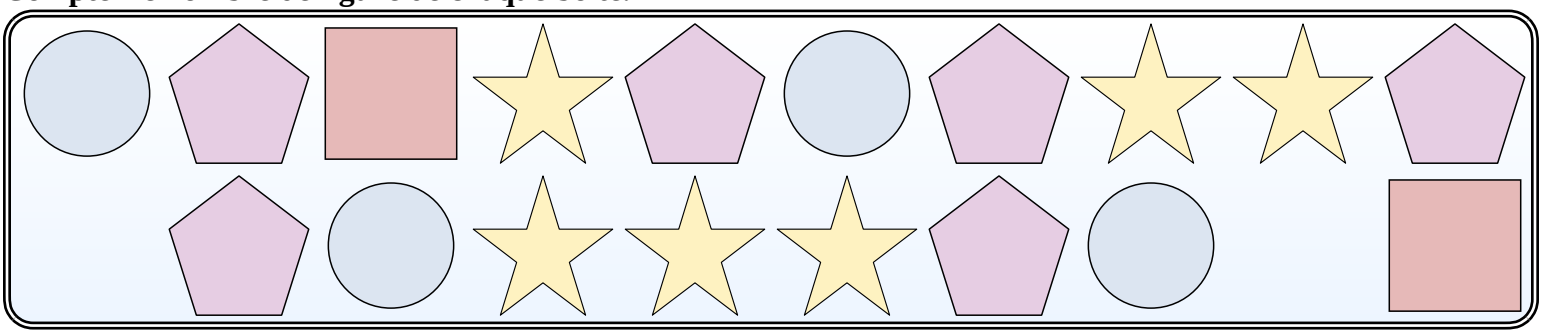

**Ex)** = 4

**1)** 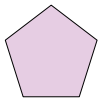 = _____

**2)** = _____

**3)** = _____



**4)** = _____

**5)** = _____

**6)** = _____

**7)** = _____



**8)** = _____

**9)** = _____

**10)** = _____

**11)** = _____



| | | | | | | | | | | |
|---|---|---|---|---|---|---|---|---|---|---|
| 1-10 | 91 | 82 | 73 | 64 | 55 | 45 | 36 | 27 | 18 | 9 |
| 11 | 0 | | | | | | | | | |

Compter des Figures Nom: **Clé**

**Comptez le nombre de figure de chaque boîte.**

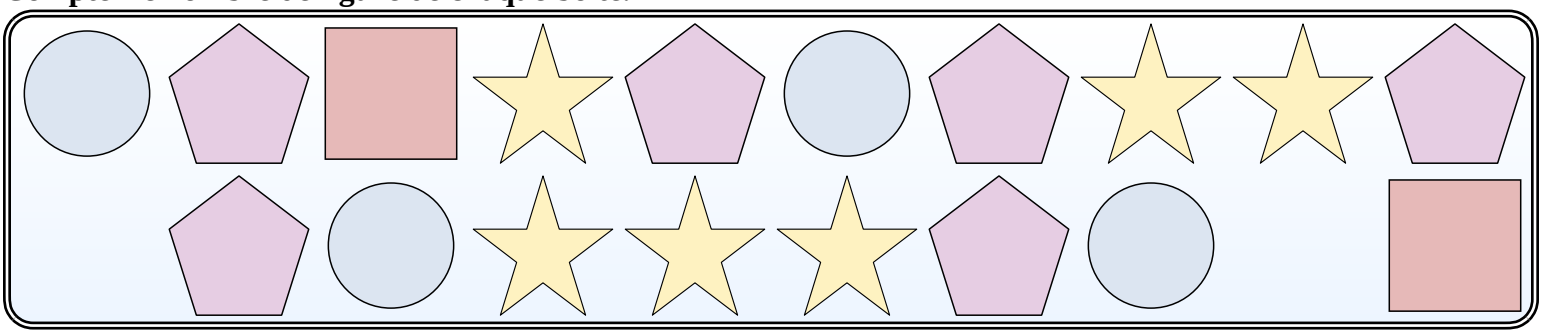

**Ex)** = 4

**1)** 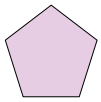 = 6

**2)** = 2

**3)** = 6



**4)** = 4

**5)** = 5

**6)** = 3

**7)** = 5



**8)** = 6

**9)** = 3

**10)** = 7

**11)** = 3



| | | | | | | | | | | |
|---|---|---|---|---|---|---|---|---|---|---|
| 1-10 | 91 | 82 | 73 | 64 | 55 | 45 | 36 | 27 | 18 | 9 |
| 11 | 0 | | | | | | | | | |

Compter des Figures Nom:

**Comptez le nombre de figure de chaque boîte.**

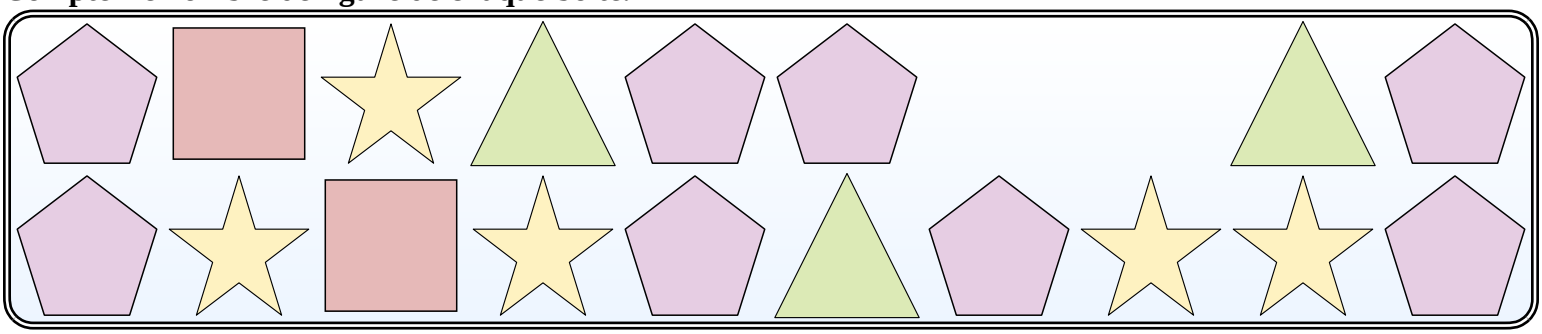

**Ex)** 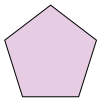 = 8

**1)** = _____

**2)** = _____

**3)** = _____



**4)** = _____

**5)** = _____

**6)** = _____

**7)** = _____

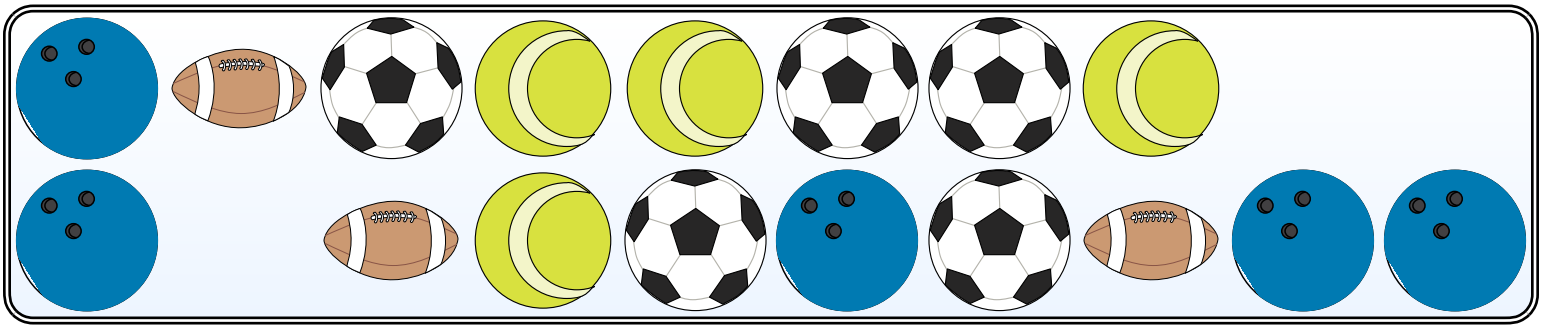

**8)**  = _____

**9)** = _____

**10)** = _____

**11)** = _____



| | | | | | | | | | | |
|---|---|---|---|---|---|---|---|---|---|---|
| 1-10 | 91 | 82 | 73 | 64 | 55 | 45 | 36 | 27 | 18 | 9 |
| 11 | 0 | | | | | | | | | |

Compter des Figures Nom: **Clé**

**Comptez le nombre de figure de chaque boîte.**

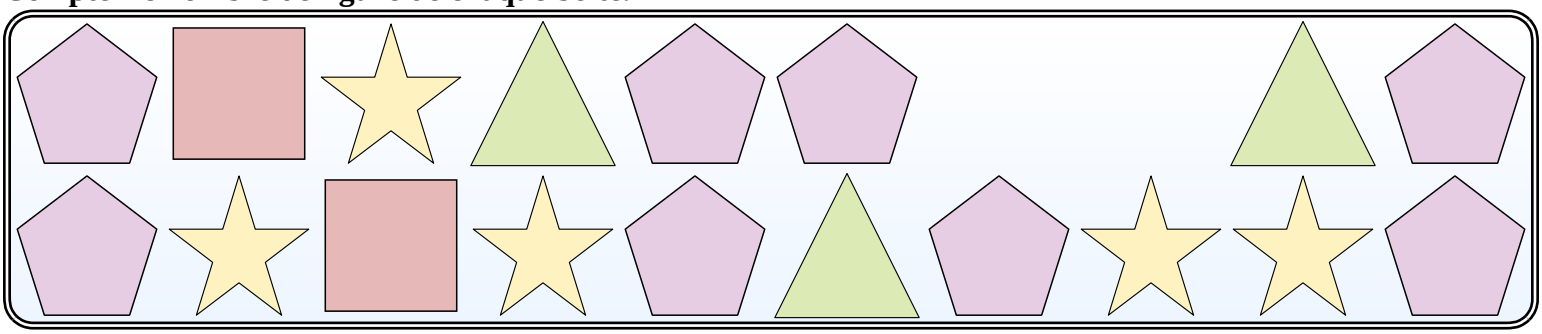

**Ex)** 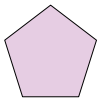 = 8

**1)** = 2

**2)** = 5

**3)** = 3



**4)** = 5

**5)** = 3

**6)** = 4

**7)** = 7

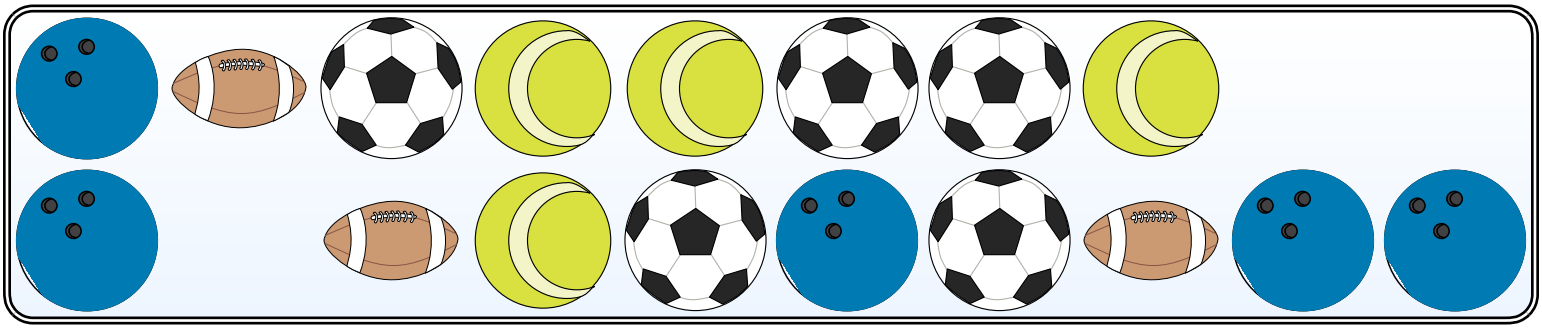

**8)**  = 5

**9)** = 3

**10)** = 5

**11)** = 4



| | | | | | | | | | | |
|---|---|---|---|---|---|---|---|---|---|---|
| 1-10 | 91 | 82 | 73 | 64 | 55 | 45 | 36 | 27 | 18 | 9 |
| 11 | 0 | | | | | | | | | |

Compter des Figures Nom:

**Comptez le nombre de figure de chaque boîte.**

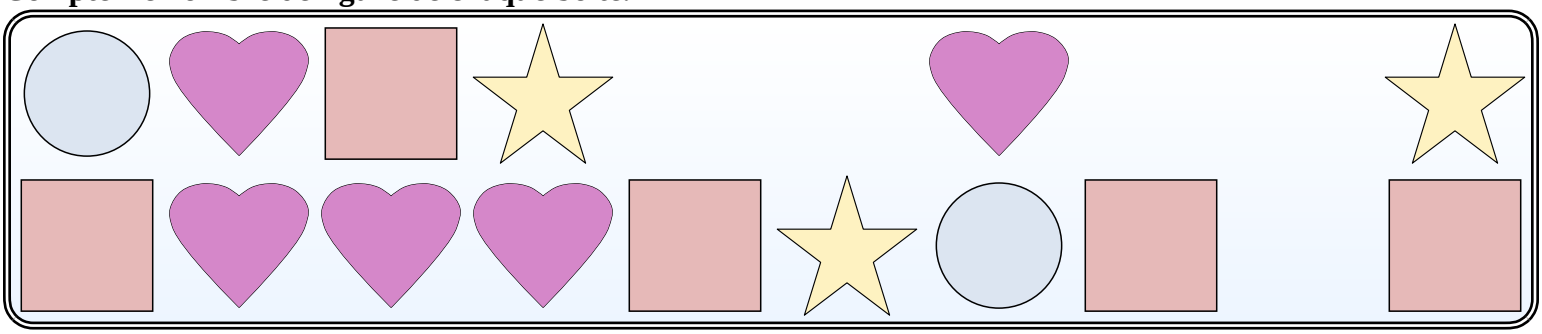

**Ex)** = 2

**1)** = _____

**2)** = _____

**3)** = _____

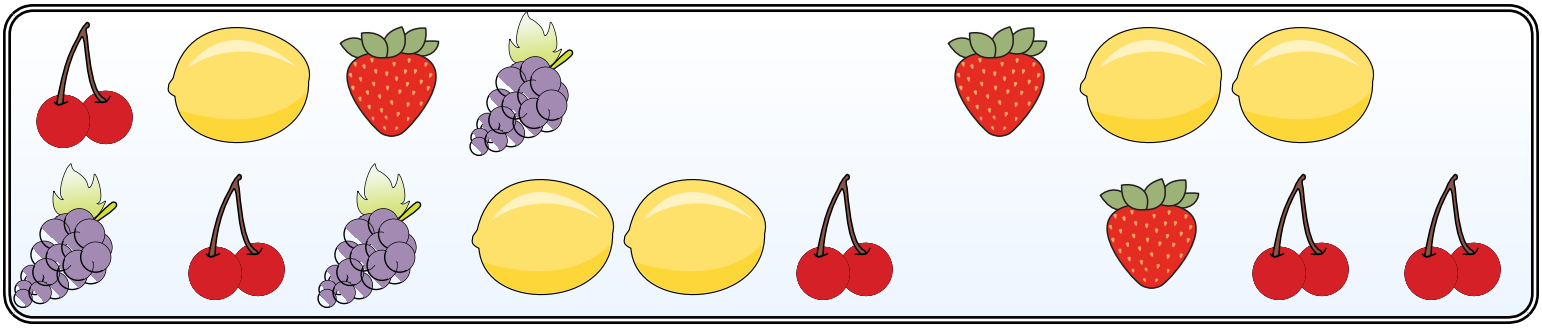

**4)** = _____

**5)** = _____

**6)** = _____

**7)** = _____



**8)** = _____

**9)** = _____

**10)** = _____

**11)** = _____



| | | | | | | | | | | |
|---|---|---|---|---|---|---|---|---|---|---|
| 1-10 | 91 | 82 | 73 | 64 | 55 | 45 | 36 | 27 | 18 | 9 |
| 11 | 0 | | | | | | | | | |

Compter des Figures Nom: **Clé**

**Comptez le nombre de figure de chaque boîte.**

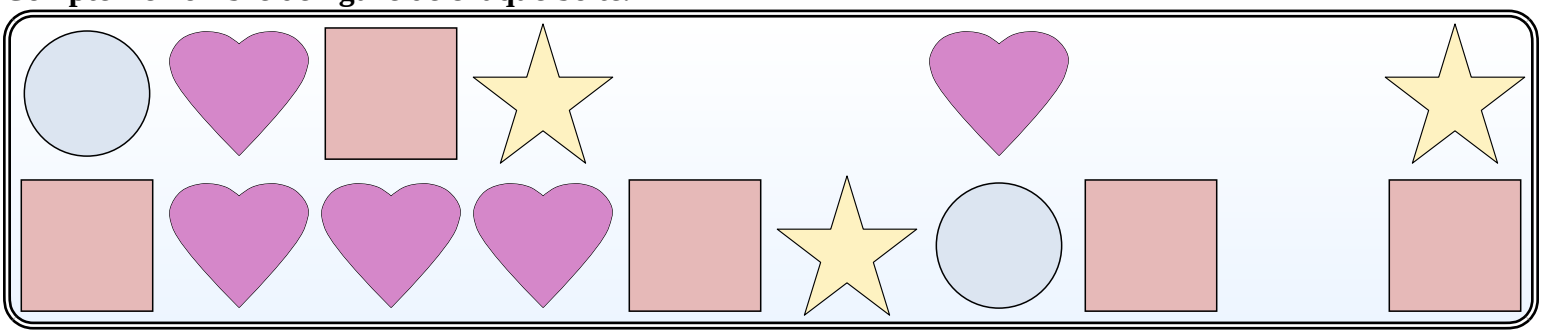

**Ex)** = 2

**1)** = 5

**2)** = 5

**3)** = 3

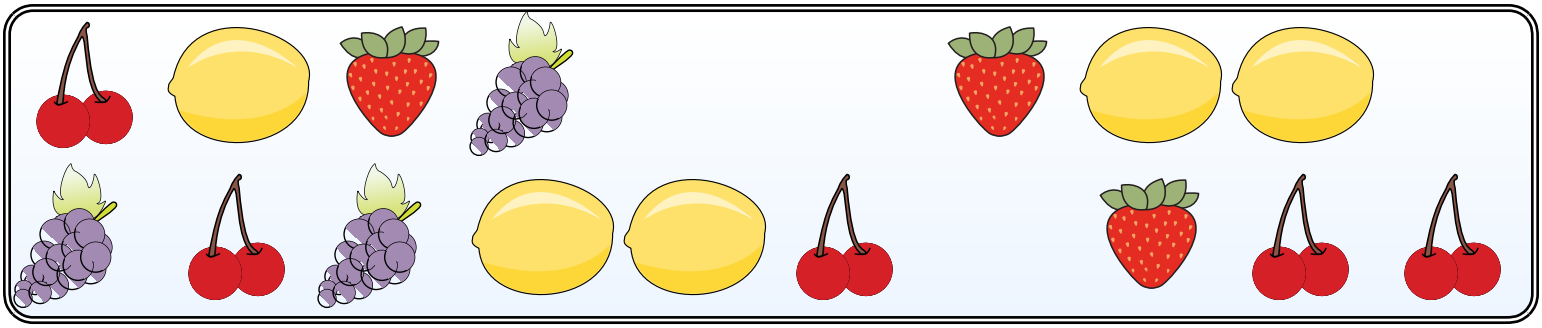

**4)** = 5

**5)** = 5

**6)** = 3

**7)** = 3



**8)** = 6

**9)** = 3

**10)** = 4

**11)** = 5



| | | | | | | | | | | |
|---|---|---|---|---|---|---|---|---|---|---|
| 1-10 | 91 | 82 | 73 | 64 | 55 | 45 | 36 | 27 | 18 | 9 |
| 11 | 0 | | | | | | | | | |

Compter des Figures Nom:

**Comptez le nombre de figure de chaque boîte.**

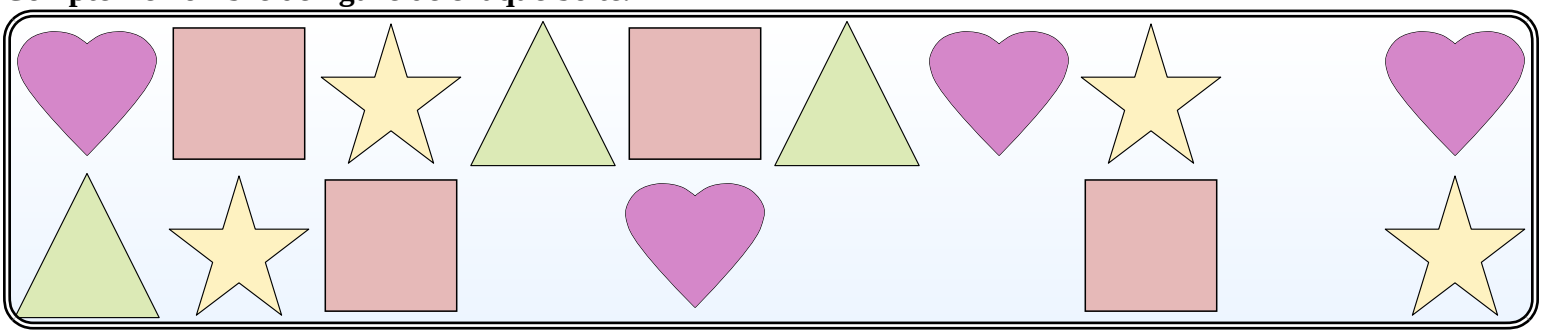

**Ex)** = 4

**1)** = _____

**2)** = _____

**3)** 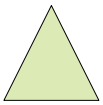 = _____



**4)** = _____

**5)** = _____

**6)** = _____

**7)** = _____

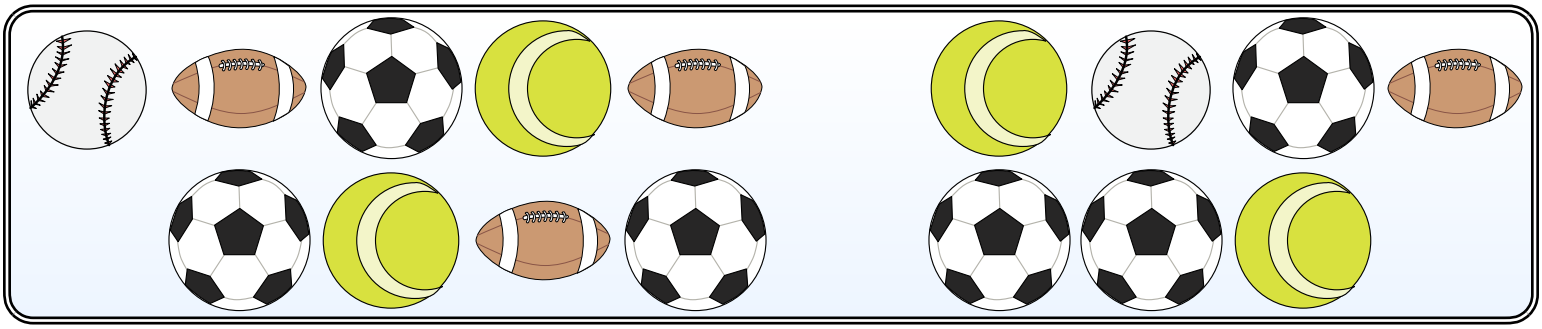

**8)** = _____

**9)** = _____

**10)** = _____

**11)** = _____



| | | | | | | | | | | |
|---|---|---|---|---|---|---|---|---|---|---|
| 1-10 | 91 | 82 | 73 | 64 | 55 | 45 | 36 | 27 | 18 | 9 |
| 11 | 0 | | | | | | | | | |

Compter des Figures Nom: **Clé**

**Comptez le nombre de figure de chaque boîte.**

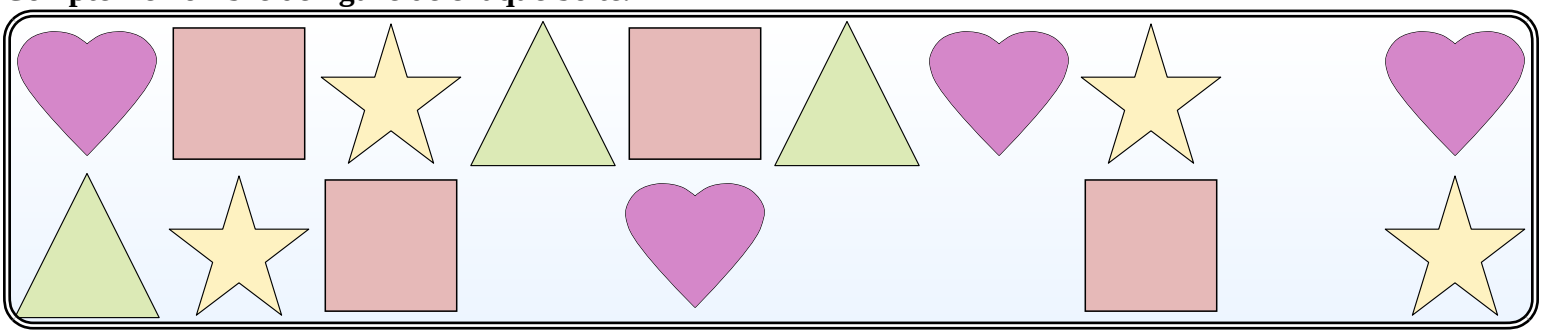

**Ex)** = 4

**1)** = 4

**2)** = 4

**3)** = 3



**4)** = 6

**5)** = 2

**6)** = 5

**7)** = 6

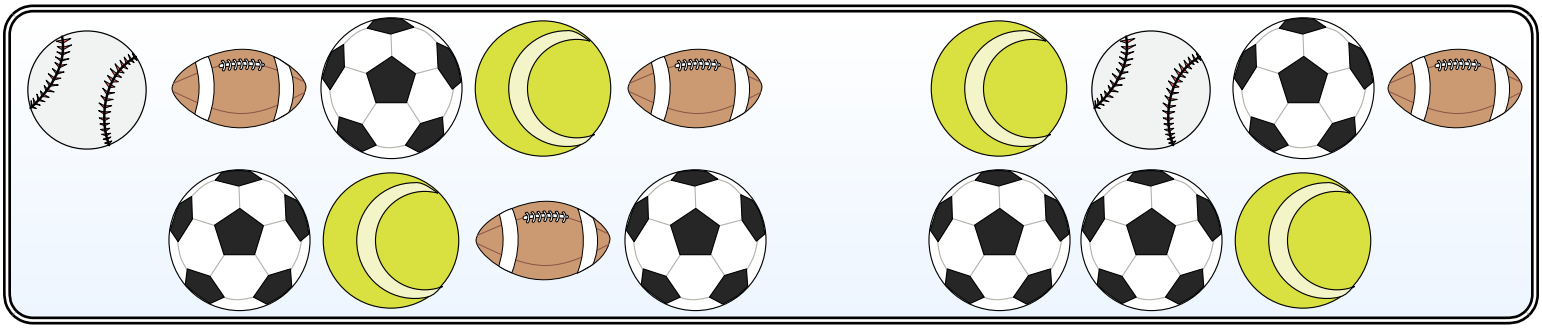

**8)** = 2

**9)** = 4

**10)** = 6

**11)** = 4



| | | | | | | | | | | |
|---|---|---|---|---|---|---|---|---|---|---|
| 1-10 | 91 | 82 | 73 | 64 | 55 | 45 | 36 | 27 | 18 | 9 |
| 11 | 0 | | | | | | | | | |

Compter des Figures Nom:

**Comptez le nombre de figure de chaque boîte.**

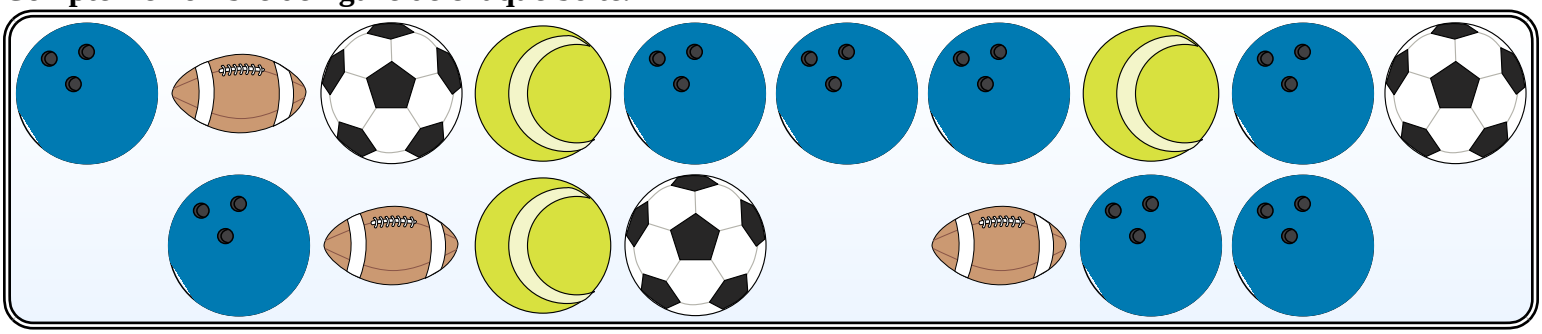

**Ex)** = 8

**1)** = _____

**2)** = _____

**3)** = _____



**4)** = _____

**5)** = _____

**6)** = _____

**7)** = _____

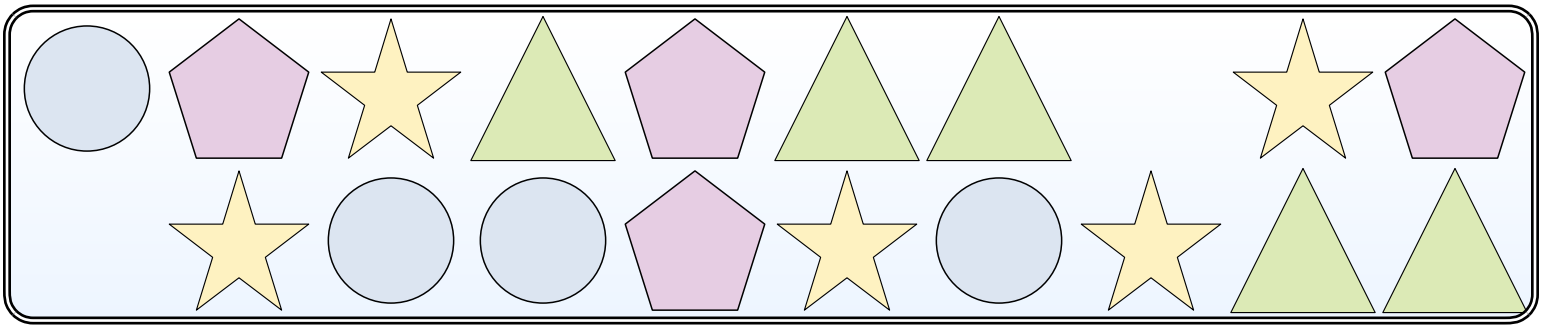

**8)** = _____

**9)** 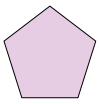 = _____

**10)** = _____

**11)** = _____



| | | | | | | | | | | |
|---|---|---|---|---|---|---|---|---|---|---|
| 1-10 | 91 | 82 | 73 | 64 | 55 | 45 | 36 | 27 | 18 | 9 |
| 11 | 0 | | | | | | | | | |

Compter des Figures Nom: **Clé**

**Comptez le nombre de figure de chaque boîte.**

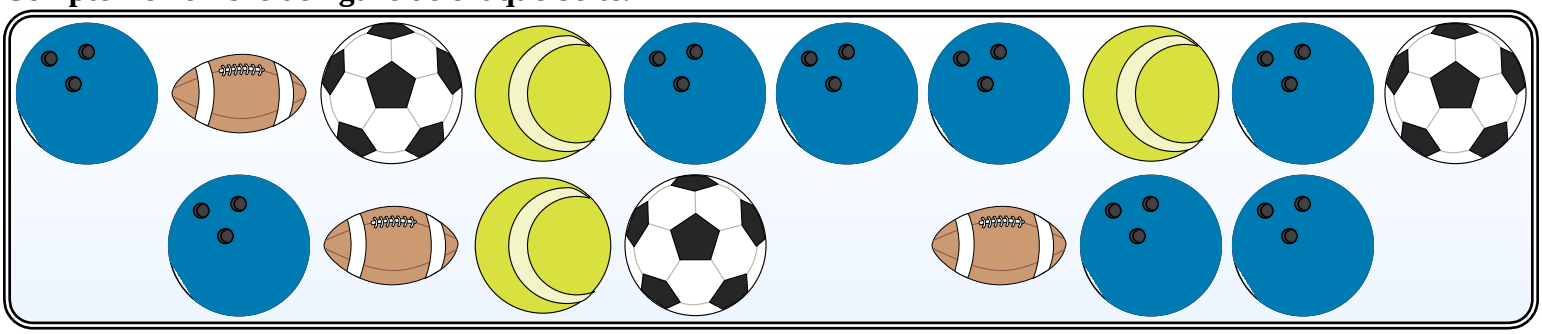

**Ex)** = 8

**1)** = 3

**2)** = 3

**3)** = 3



**4)** = 6

**5)** = 5

**6)** = 4

**7)** = 3

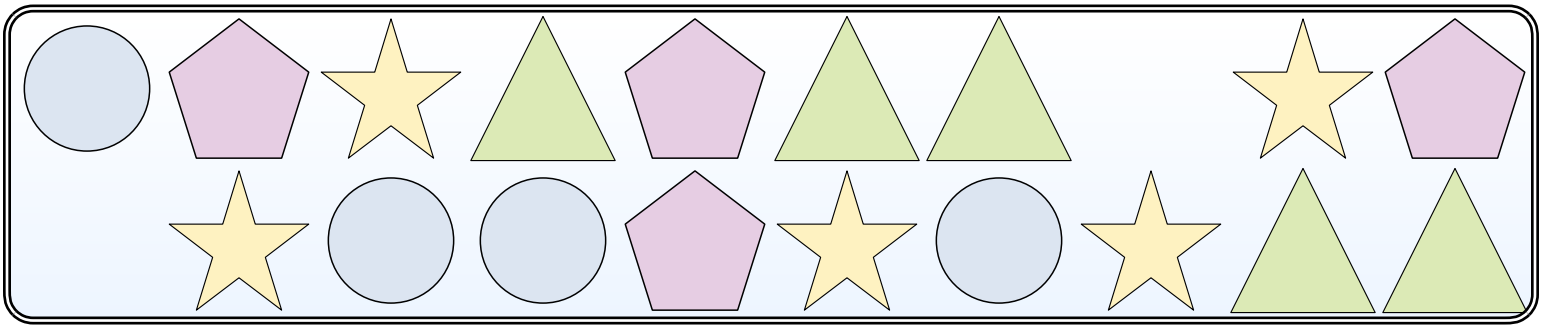

**8)** = 4

**9)** 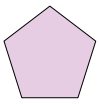 = 4

**10)** = 5

**11)** = 5



| | | | | | | | | | | |
|---|---|---|---|---|---|---|---|---|---|---|
| 1-10 | 91 | 82 | 73 | 64 | 55 | 45 | 36 | 27 | 18 | 9 |
| 11 | 0 | | | | | | | | | |

Compter des Figures Nom:

**Comptez le nombre de figure de chaque boîte.**



**Ex)** = 4

**1)** = _____

**2)** = _____

**3)** = _____



**4)** = _____

**5)** = _____

**6)** = _____

**7)** = _____

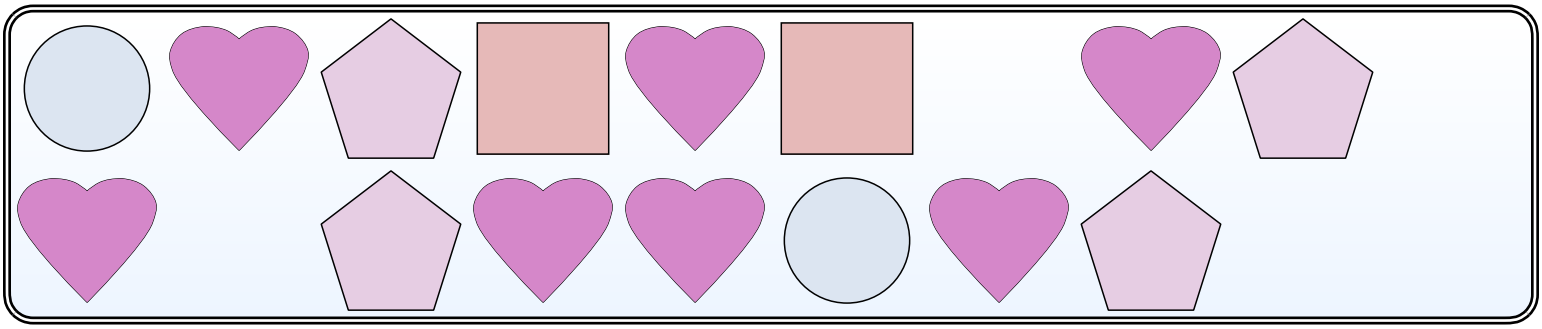

**8)** = _____

**9)** = _____

**10)** 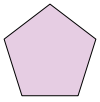 = _____

**11)** = _____



| | | | | | | | | | | |
|---|---|---|---|---|---|---|---|---|---|---|
| 1-10 | 91 | 82 | 73 | 64 | 55 | 45 | 36 | 27 | 18 | 9 |
| 11 | 0 | | | | | | | | | |

Compter des Figures Nom: **Clé**

**Comptez le nombre de figure de chaque boîte.**



**Ex)** = 4

**1)** = 6

**2)** = 3

**3)** = 4



**4)** = 5

**5)** = 3

**6)** = 4

**7)** = 2

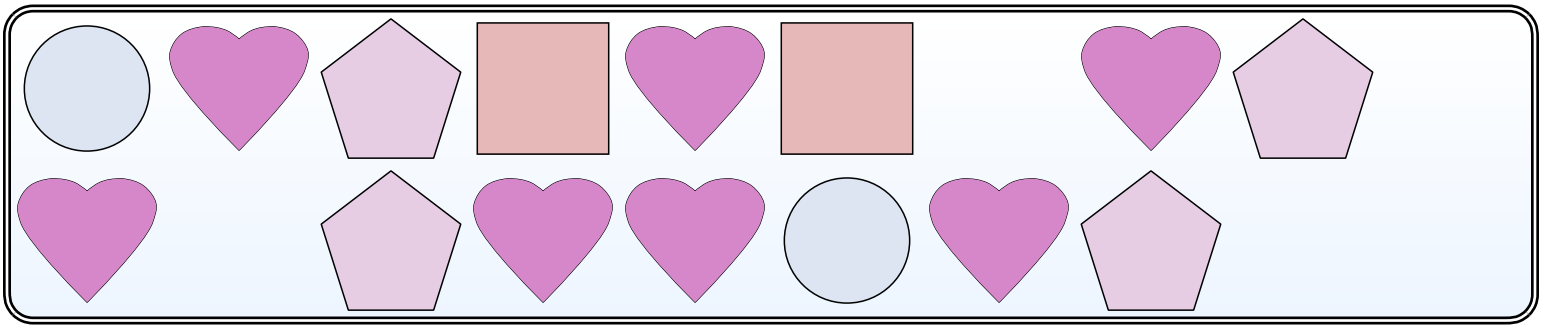

**8)** = 2

**9)** = 7

**10)** 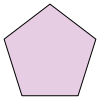 = 4

**11)** = 2



| | | | | | | | | | | |
|---|---|---|---|---|---|---|---|---|---|---|
| 1-10 | 91 | 82 | 73 | 64 | 55 | 45 | 36 | 27 | 18 | 9 |
| 11 | 0 | | | | | | | | | |